Zbrajanje i oduzimanje brojeva do 10

1 Dopuni brojeve koji nedostaju na brojevnoj crti. Riješi zadatke:

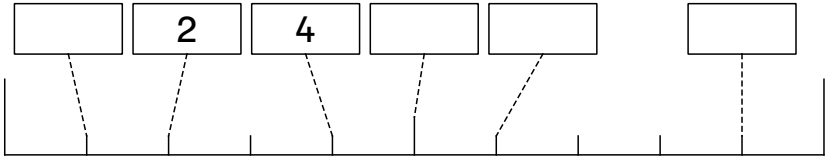

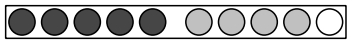
__ + __ = __

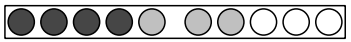
__ + __ = __

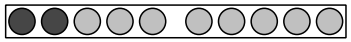
__ + __ = ____

__ + __ = __

__ + __ = __

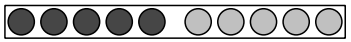
__ + __ = ____

__ + __ = __

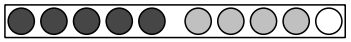
__ + __ = __

__ + __ = __

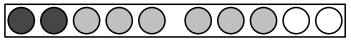
__ + __ = __

__ + __ = ____

__ + __ = ____

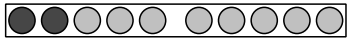
__ + __ = ____

__ + __ = __

__ + __ = ____

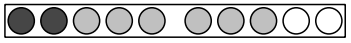
__ + __ = __

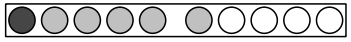
__ + __ = __

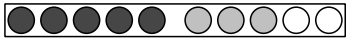
__ + __ = __

Dopuni brojevnu crtu. Izračunaj:

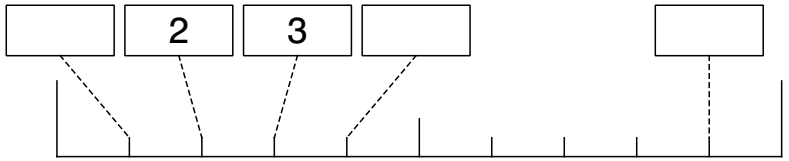

__ - __ = __

____ - __ = __

__ - __ = __

__ - __ = __

__ - __ = __

__ - __ = __

__ - __ = __

__ - __ = __

__ - __ = __

__ - __ = __

__ - __ = __

__ - __ = __

____ - __ = __

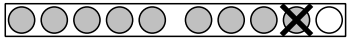
__ - __ = __

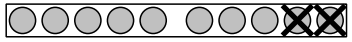
__ - __ = __

__ - __ = __

__ - __ = __

__ - __ = __

__ - __ = __

__ - __ = __